Name _____

Bass Clef Ledger Lines

Name the ledger lines above:



Name the ledger lines below:



Name both above/below ledger lines:







©MichaelKravchuk.com